DAWOOD PUBLIC SCHOOL
Summer Vacation Homework
GRADE I (2021-22)
Promoted to GRADE II (2022-23)

MY BOOK REVIEW



Task 1:

Read the following story books and write a review of the ONE that you liked the most.

1. **Clementine Rose and the Pet day disaster** by Jacqueline Harvey
2. **I Can Read with the Eyes Shut** by Dr Suess
3. **The Sneetches and Other Stories** by Dr Suess
4. **Sam and Dave Dig a Hole** by Mac Barnett, illustrated by Jon Klassen
5. **Clementine** by Sara Pennypacker



Draw the title page of the story and write the names of the characters you liked most in this story.





Task 2:

Take interview of any elder member of your family and fill the given form

Name of the interviewer: _____

Name of the family member: _____

1. What is your favorite food

_____

2. What is your favourite season

_____

3. What is your favourite sport

_____

4. What is your favourite book

_____

5. What is your favourite place



_____

Task 3:

Learn the song lyrics uploaded on Google Music Classroom for the upcoming play (drama - Alice in Wonderland).

Homework Submission:

Kindly submit your homework between 10th to 12th August 2022.

Note:

The School Library will remain approachable during summer break for students to borrow books for the joy of reading.

Dawood Public School
Holidays Homework 2022-23
Subject: Mathematics
Primary Section.

General Instructions

Dear Students,

1. Please attempt questions from all sections detailed below. Questions may be printed out or solved on file paper. Calculators are NOT allowed.
2. Please write correct question numbers if you are not writing the questions along; solve all questions in the order they are given. Begin each assignment on a fresh page.
3. Please complete all assignments independently, as they will be graded.
4. All assignments must be completed before coming to school.

Enjoy your summer break!

(For Upcoming Grade 2)

Task 1:

Revise tables 2 till 5

Task 2:

Make a booklet. Complete the information about yourself using numbers only and decorate it.

Note: Samples of booklet have been given. You may use your own creativity.

1) Letters in my name
2) My age
3) My class
4) My height
5) Members in my family
6) Number of teeth I have
7) My shoe size
8) Number of siblings
9) Number of friends I have
10) Number of books had in grade 1

Material:

A-4 size coloured computer pages, colour pencils and markers.

Task 3:

Watch the given link and make a place value chart.

https://www.youtube.com/watch?v=LbEqH25ndf0



Task 4:

Solve the given worksheets.

Worksheet no 1

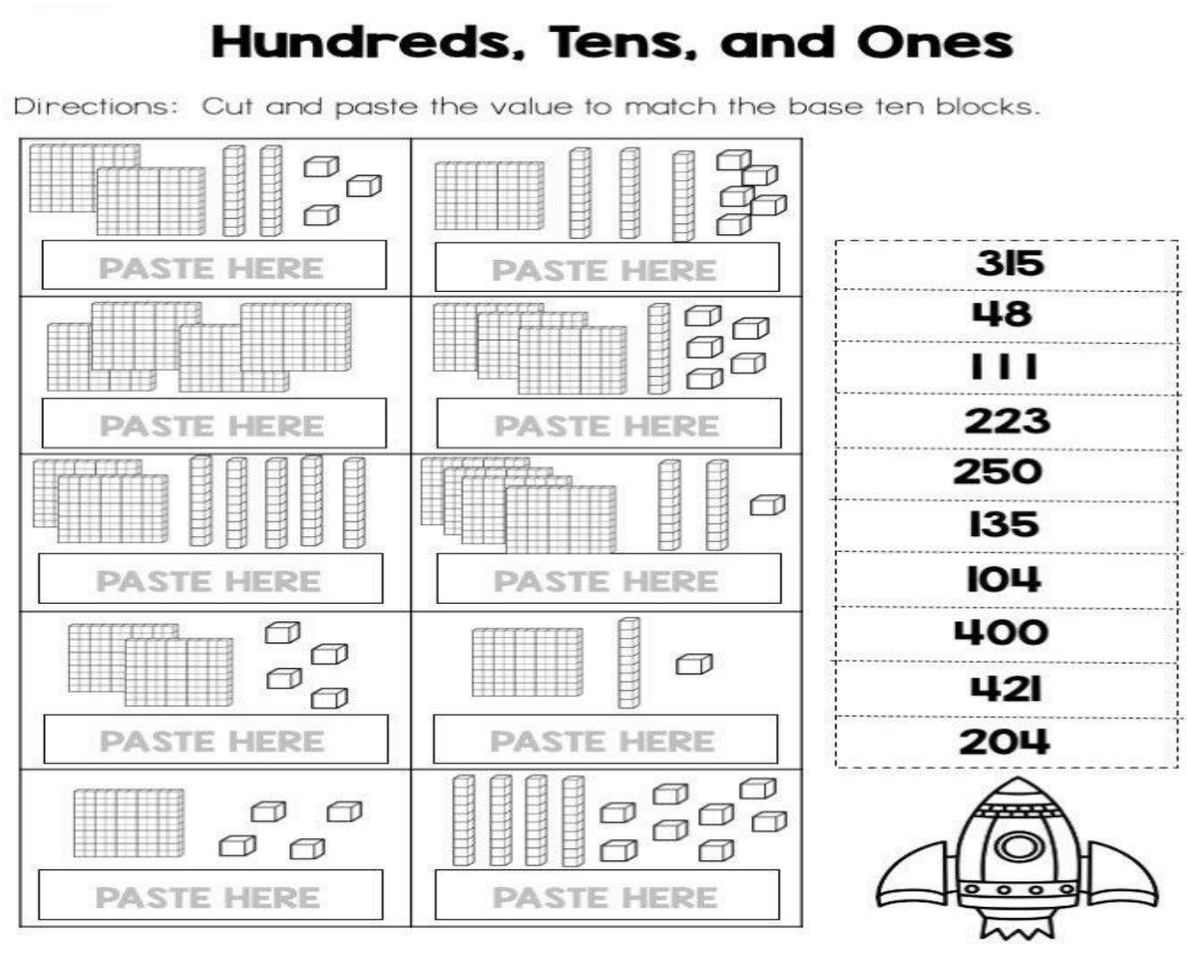

Worksheet no 2:

Quadra’s square puzzle

1) Write the numbers 1, 2, 2, 2, 3 in the correct place so that each side of the square adds up to 6.

1 2 2 2 3

Total must be 6

3		
		1
1		

2) Can you write the numbers 2, 2, 4, 6, 6 in the correct place so that each side of the square adds up to 12?

2 2 4 6 6

Total must be 12

6		
4		2

Worksheet no 3

Q) Solve the following.

65 + 90	34 - 11	72 + 71	54 - 22	74 + 25	28 - 11	65 + 84
57 - 57	17 + 78	64 - 64	47 - 15	60 - 57	78 - 10	59 + 29
56 + 73	77 - 64	59 + 48	48 + 32	38 - 11	59 + 37	24 - 18
77 - 15	16 - 10	42 - 16	88 + 76	42 - 25	11 + 95	63 - 21

For Upcoming Grade III

Task 1:

1. Look at the numbers on the grid and answer the questions below:'

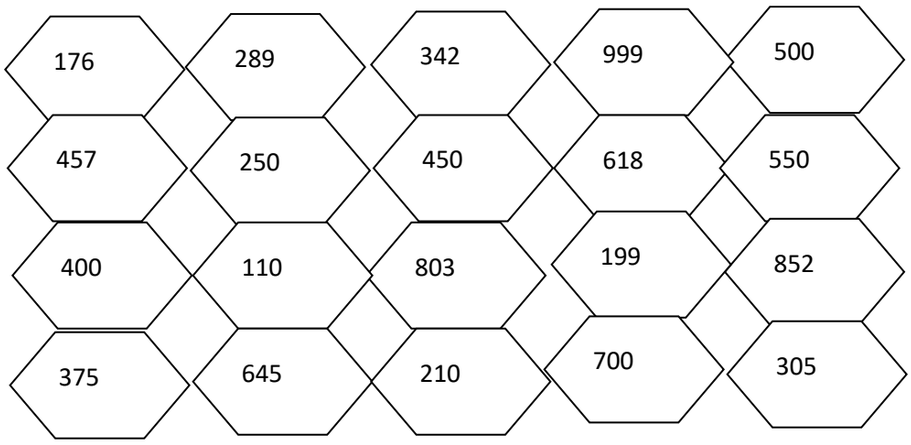

a. The largest odd number _____

b. The smallest even number _____

c. Write all the numbers that are more than 200. _____

d. Which number is one less than one thousand? _____

e. Which two even numbers add up to 900? _____ and _____.

f. The sum of the first and last number on the grid is _____.

Task 2:

Complete these puzzles.

6	5	12
12	15	36
36	60	144
144	300	?

9	−	1	−	?	= 2
+		×		+	
?	×	7	×	4	= 56
×		×		×	
5	×	8	+	?	= 43
= 19		= 56		= 18	

Task 3:

Q . Use the numbers

1 , 2 , 3 , 4 , 5 , 6 , 7 , 8 , 9

To fill in the bubbles so that the sum around each hexagon adds up to 30. You can use the numbers more than once... and you won't need to use all of them.

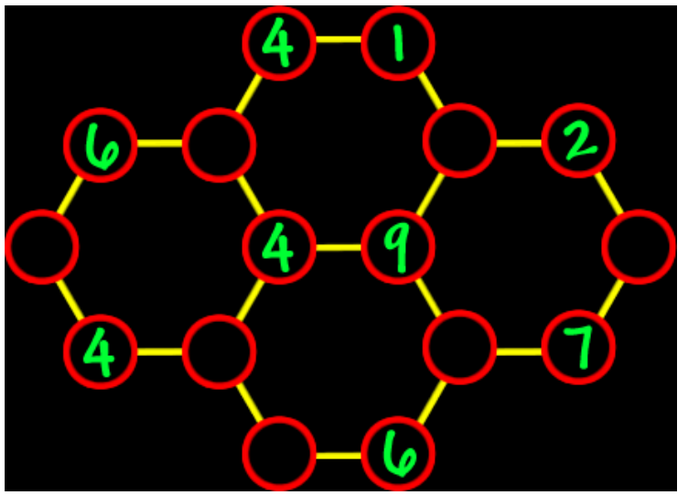

For Upcoming Grade IV

Task 1:

Q.) How much change you will get?

RS. 5	Rs.30	Rs.15	Rs.25

Purchase these food	**Pay**	**How much change**
Apple and donut	Rs 40	
Donut and juice	Rs 50	
Two pizza slice	Rs.100	
Juice and pizza slice	Rs.80	

Task 2:

Q) See the following link and follow the instruction and make the activity for expanded and standard form.

https://www.youtube.com/watch?v=Kpj7Rt2qT6o

Task3:

Q.1) Write in digital or analog time.

a) 4:30 ……

b) Quarter past 3 ……

c) Quarter to 9 ……

d) 1:15……..

e) 2:00…….

Q.2)

Help Florafox match the time shown on the analog clocks with the times on the right!

1.
2.
3.
4.
5.
6.
7.

a) 7:15

b) 10:05

c) 6:45

d) 5:45

e) 12:40

f) 8:10

g) 3:10

For Upcoming Grade V

Task 1:

Take currency notes of different denominations and measure their length and breadth to nearest centimeters. Find out their area and perimeter. Record findings in your folder and paste a photocopy of currency notes.

Task 2:

Make a paper plate cake (upside down) and take pictures of it.

Now follow the following instructions.

1) Cut the cake into eight equal parts and take the picture of it and paste it

2) Give two pieces to your parents, how much is remaining, write the fraction of it …….

3) Now you eat one, what fraction is left …….

4) Take a picture of the remaining cake.

Task 3:

Use the digits 1, 5, 4, 9, 8, 2, 0

a) Make 3- digit **three odd** and **three even** numbers.
b) Make a table to separate numbers divisible by 2 , 5 and 10 from part a.
c) Find the difference between the biggest and smallest number.

NOTE:

Make a booklet using colored computer papers for all above mentioned tasks

Task 4: Learn the tables from 2- 15

For Upcoming Grade VI

Task 1:

Q1: Fill in the missing values:

6	+		=	14
+		+		+
	+	9	=	16
=		=		=
13	+		=	

20	-	12	=	
+		+		+
25	-		=	13
=		=		=
	-		=	

Task 2:

Q1. Below is a map of a house. The measurements of the rooms are given below. Use the floor plan to find the area and perimeter of:

a) Bathroom

b) Entry hall

c) Back porch

d) Living room

e) Kitchen

f) Covered porch

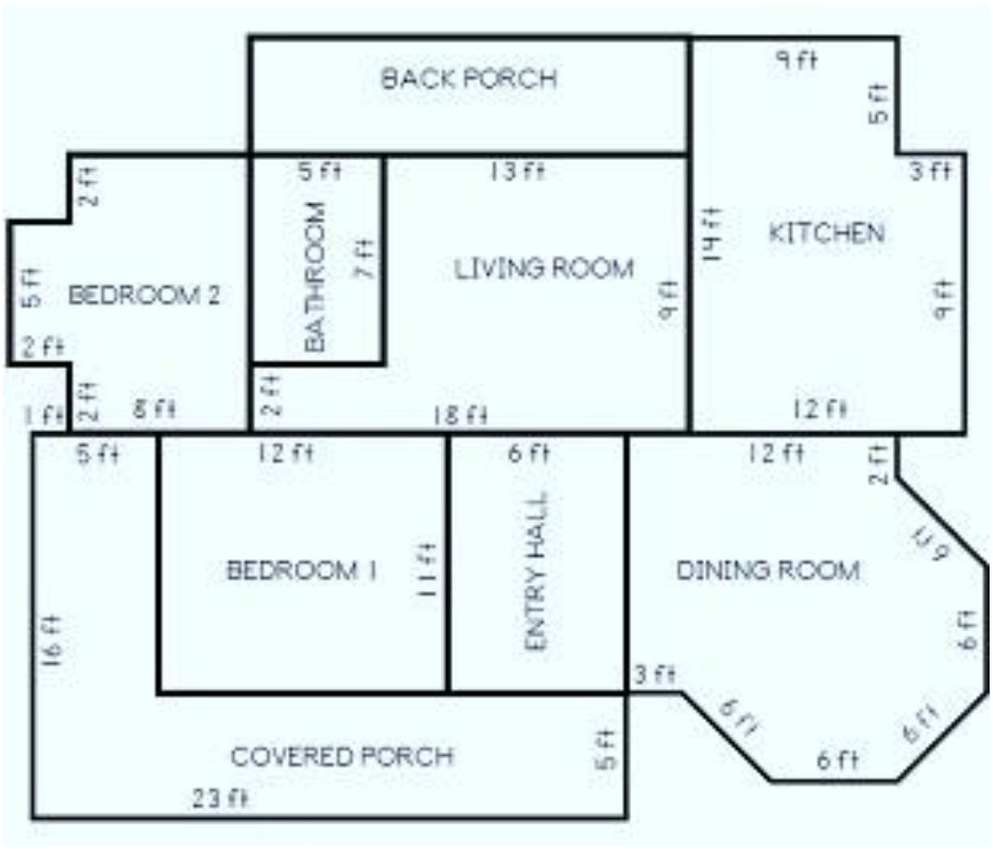

Task 3:

MATHS INTEGRATED PROJECT (To be done in a scrapbook)

You know that like we have rupees in Pakistan, other countries have other currencies. Write the currencies of the following countries and write their value in Indian rupees. s

S.no.	Country	Currency	Value in Pakistani Rupees
1	U.S.A	1 Dollar	Rs.110
2	Japan		
3	U.K		
4	China		
5	France		
6	Malaysia		
7	India		
8	Russia		
9	Srilanka		

Based on this chart answer the following questions.

1) How many Pakistani rupees will you get for 100 U.S Dollars?

2) What costs more? 1000 pounds or 1000 Euros? How much more?

3) Ali bought a purse for 120 dollars. How much did it cost in Pakistani rupee?

4) Who earns more? A man who earns 6000 Pakistani rupees in Pakistan or a man who earns 6000 Indian rupees in India.

Task 4:

Collect information about any two Mathematicians and their contribution to the subject. Also paste their pictures.

Task 5:

The following interactive links provide skill-based questions on a variety of topics. Challenge, assess and improve your skills for a better start next year!

https://www.ixl.com/math/grade-5

http://www.aplusclick.com/t.htm?level=5;t=0

Dawood Public School
Summer Vacation Homework
Subject: Urdu
For New Grade: II
[Session 2022-23]

پیارے بچوں گرمیوں کی تعطیلات میں آپ بہت خوش ہونگے اور اپنی پسندیدہ سرگرمیوں مثلاً رشتہ داروں، دوستوں سے ملاقات ، کھیل کود سیر و تفریح سے لطف اندوز ہونگے۔ اُمید ہے اس کے ساتھ ساتھ آپ کتب بینی کے لیے بھی وقت نکالیں گے۔ اس سلسلے میں آپ کو کچھ کتابیں دی جارہیں ہیں ان میں سے کسی ایک کتاب کا مطالعہ کریں اور اس کے بارے میں دیا گیا فارم پُر کریں۔

نمبر شمار	کتاب کا نام	پبلشرز / لنک
1	بلّی کا بچّہ	https://www.urdupoint.com/kids/category/moral-stories.html
2	بیوقوف گدھے کی کہانی	https://youtu.be/j2r1mCrdf8Y
3	نانی	بُک گروپ پبلشرز

دی گئی کتابوں اور لنک کے ذریعے پڑھ کر دیے گئے سوالات کے جوابات لکھیئے۔ ان کتابوں کے کے علاوہ آپ اپنی پسند کی بھی کوئی کتاب پڑھ کر دیئے گے سوالات کے جواب لکھ سکتے ہیں۔

☆۔ ایک مختصر کتابچہ عنوان کے ساتھ ترتیب دیں جس میں عید الاضحی میں قربان کیے جانے والے جانوروں کی تصاویر چسپاں کریں نیز ان کے بارے میں دو یا تین سطریں لکھیں اور اس کے ساتھ یہ بھی بتایئے کہ آپ نے عید الاضحیٰ کا دن کیسے گزارا۔

نوٹ: آپ کی یہ کاوش ماہ اگست کے ٹیسٹ میں شامل کی جائے گی۔

یہ ہوم ورک اُن طالبات کے لیے ہے جو جماعت اوّل سے جماعت دوم میں آئی ہیں۔

ہوم ورک جمع کروانے کی تاریخ 10 سے 12 اگست 2022 ہے۔

تبصرہ کتب

جماعت اوّل تا سوم

طالبہ کا نام_____ کتاب کا عنوان_____

جماعت:_____ مصنف_____

موضوع:_____

کتاب کا نیا سرورق بنائیں۔



۔کتاب کے متعلق ایک تصویر بنائیں



کتاب کے متعلق چار جملے تحریر کریں

_____

_____

_____

_____