DAWOOD PUBLIC SCHOOL
HOME WORK: SCIENCE (Task 4)
GRADE II

Q.1. Sara is given two solids, talcum powder and salt. Both look the same. Her teacher asks her to tell without smelling.

1.What can Sara do to find out which solid is talcum powder and which is salt?

_____

_____

_____

Q.2. Colour the things that can be bent.

Wooden ruler	**Socks**	**Plastic dice**	**Ribbon bow**	**Nail**

Q.3. Sara uses exercise band and stretches it as shown in the picture below.

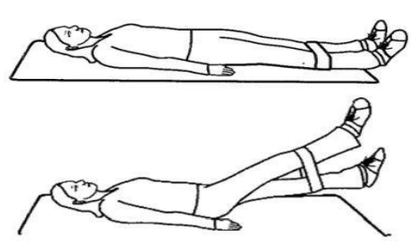

1.**Does the exercise band change its shape?**

_____

2.Does it become shorter or longer?

_____

3.Is it elastic or non-elastic?

_____

4.Can the exercise band turn to its original shape when Sara stops stretching it?

_____

5.Which of the following objects cannot be stretched?

Drinking can	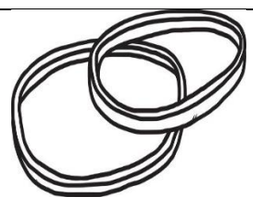 **Rubber band**	**Modeling clay**	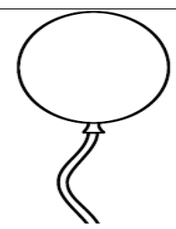 **Balloon**

Q.4. Ali has some tube ballons .He made different shapes by using these ballons.

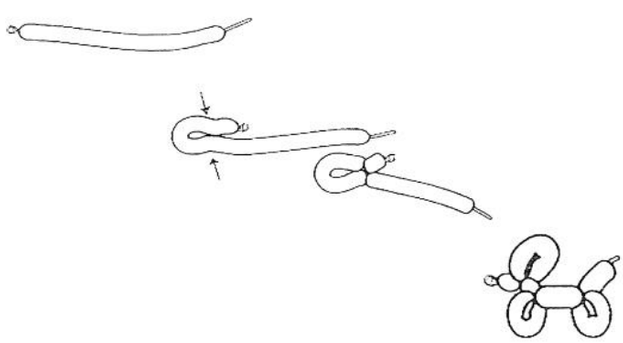

1. **Does he bent,squashed,twisted or stretched the ballon in the picture above?**

_____

2. **What happens to the shape of the ballon?**

_____

c. Write bent, stretched, squashed or twisted in the pictures below.

		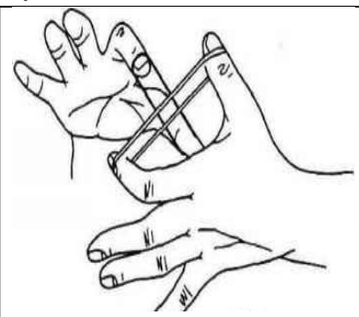	
A:_____	**B:**_____	**C:**_____	**D:**_____